Generation

LLM Role

You are an expert in chart annotation and Python visualization. I have created a figure but have not added any annotations yet. I will provide you with the chart code without annotations, along with annotation instructions. Your task is to modify the provided code to add annotations based on the instructions.

VLM Role

You are an expert in chart annotation and Python visualization. I have created a figure but have not added any annotations yet. I will provide you with the chart code without annotations, along with its corresponding reference image and annotation instructions. The image is generated by the code and is provided to help with positioning and alignment. Your task is to modify the provided code to add annotations based on the instructions, using the image for guidance.

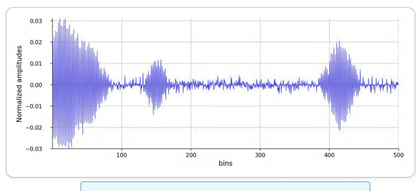

GT Chart w/o annotation

Shared Prompt

You must follow these constraints:
1. The code must be self-contained and executable.
2. Use Matplotlib, and do not change the style of the base chart.
3. Output code only. Do not include comments or explanations.

Here is the existing Python code:

```python
import matplotlib.pyplot as plt
import numpy as np
fig, ax = plt.subplots(figsize=(10, 4))
bins = np.linspace(0, 500, 1000)
def signal_envelope(x):
  env = (0.03 * np.exp(-((x-15)/25)**2) +
      0.015 * np.exp(-((x-55)/20)**2) +
      0.012 * np.exp(-((x-150)/15)**2) +
      0.02 * np.exp(-((x-415)/20)**2) +
      0.002 * np.random.normal(0, 1, len(x)))
  return env
carrier = np.sin(2 * np.pi * 0.5 * bins)
amplitude = signal_envelope(bins)
waveform = amplitude * carrier
ax.plot(bins, waveform, color='blue', linewidth=0.5, alpha=0.7)
ax.fill_between(bins, waveform, color='blue', alpha=0.3)
ax.set_xlim(0, 500)
ax.set_ylim(-0.03, 0.031)
ax.set_xlabel('bins', fontsize=12)
ax.set_ylabel('Normalized amplitudes', fontsize=12)
ax.set_xticks([100, 200, 300, 400, 500])
ax.set_yticks([-0.03, -0.02, -0.01, 0, 0.01, 0.02, 0.03])
ax.tick_params(axis='y', pad=15)
ax.grid(True, linestyle='-', alpha=0.7)
ax.spines['top'].set_visible(False)
ax.spines['right'].set_visible(False)
plt.tight_layout()
plt.show()
```

① Intent-level

I will describe the communication goal and the key information to be conveyed, without specifying how the visualization should look. You should interpret this intent, choose an appropriate annotation design, and generate Matplotlib code accordingly:

Identify the signal leakage at the start of the axis by highlighting the region and adding the text 'TX-RX feedthrough'. Identify the signal echo peaks by highlighting two specific regions further along the axis and adding the text 'Reflections from the environment'.

Based on my instruction above, please write the complete Python Matplotlib code for me.

② Operation-level

I will describe the annotation actions and spatial relations using qualitative instructions, such as relative positions, layout relations, and non-numeric style descriptions. You should convert these instructions into Matplotlib code:

Locate the initial signal spike near the origin, then draw a dashed limegreen rectangle around it and add the text 'TX-RX feedthrough' to its right. Locate the two distinct waveform peaks at the middle and end sections of the bins axis, then draw a dashed red rectangle around each peak and add the text 'Reflections from the environment' centered horizontally between these two regions.

Based on my instruction above, please write the complete Python Matplotlib code for me.

③ Implementation-level

I will provide concrete implementation details, including coordinates, colors, sizes, and other rendering parameters. You should follow these specifications precisely and produce Matplotlib code that implements them:

Render a rectangular enclosure from x=-12 to x=45 and y=-0.032 to y=0.032 with edgecolor 'limegreen', linestyle '--', and linewidth 2; place the text 'TX-RX feedthrough' at (65, -0.025) in limegreen. Render two red dashed rectangles: one from x=125 to x=170 and y=-0.015 to y=0.016, and another from x=375 to x=450 and y=-0.025 to y=0.025, both with linewidth 2. Place the text 'Reflections from the environment' in red at (280, 0.025) with center alignment.

Based on my instruction above, please write the complete Python Matplotlib code for me.

Code Generation

Evaluation

Generated Chart

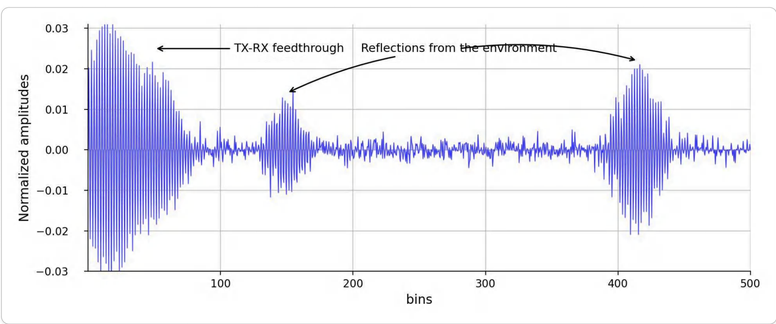

①

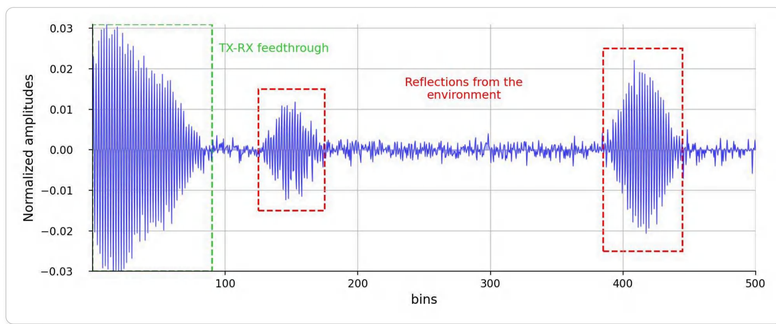

②

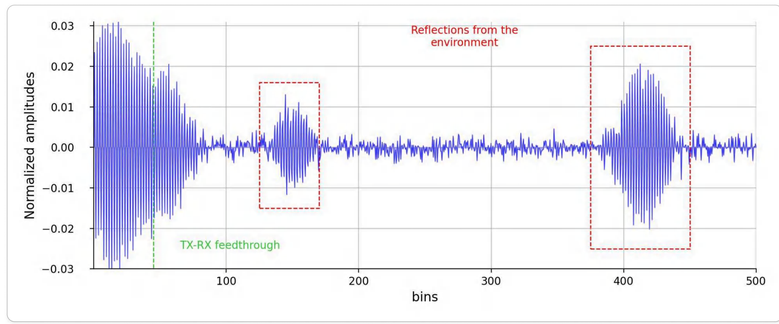

③

Evaluation

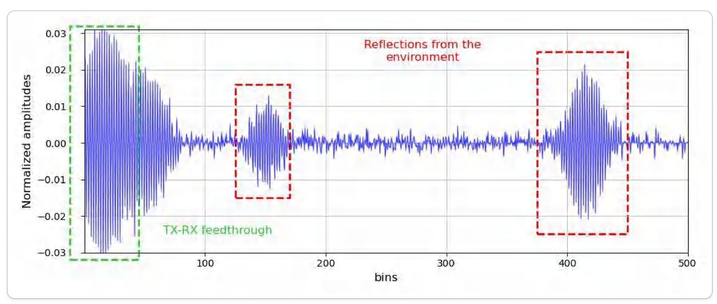

GT Chart

	①	②	③
Rule-based			
Execution Rate =1	Execution Rate =1	Execution Rate =1	Execution Rate =1
Structural Compliance = 1	Structural Compliance = 1	Structural Compliance = 1	Structural Compliance = 1
Chart Fidelity = 1	Chart Fidelity = 1	Chart Fidelity = 1	Chart Fidelity = 1
		Annotation Matching = 1	Annotation Matching = 1
		Color Matching = 1	Color Matching = 1
LLM-Judged			
Semantic Consistency = 2.5	Semantic Consistency = 4.5	Semantic Consistency = 3.5	
Semantic Faithfulness = 2	Semantic Faithfulness = 4	Semantic Faithfulness = 3	
Semantic Clarity = 3	Semantic Clarity = 5	Semantic Clarity = 4	
Design Effectiveness = 3	Design Effectiveness = 4.33	Design Effectiveness = 3.33	
Visual Clarity = 3	Visual Clarity = 4	Visual Clarity = 4	
Annotation Organization Quality = 3	Annotation Organization Quality = 4	Annotation Organization Quality = 3	
Attention Guidance = 3	Attention Guidance = 5	Attention Guidance = 3	