Q: Imagine that the image represents tic-tac-toe. What are the symbols of the two teams? Answer with one of the following answer choices: chocolate and cracker, chocolate and marshmallow, cracker and marshmallow.

A: Chocolate and marshmallow

Q: Imagine that the image represents tic-tac-toe. What team has more symbols played on the board? Answer with one of the following answer choices: cucumber, lettuce, tomato, equal.

A: Tomato

Q: Imagine that the image represents tic-tac-toe. What team is leading the game? Answer with one of the following answer choices: hula hoop, red frisbee, yellow frisbee, uncertain.

A: Yellow frisbee

Q: Imagine that the image represents a maze. What are the walls made of? Answer with one of the following answer choices: lights, mirror, stairs.

A: Mirror

Q: Imagine that the image represents a maze. What is the player in this maze? Return none if there is no player. Answer with one of the following answer choices: ball, heart, icing, none.

A: Ball



Q: Imagine that the image represents a maze. Are there clear entrances or exits in the maze? Answer with one of the following answer choices: yes, no.

A: Yes

Q: Imagine that the image represents a treasure map. What is the path made of? Answer with one of the following answer choices: black line, red line, stickers, tortilla marking.

A: Black line

Q: Imagine that the image represents a treasure map. Based on the image, find the starting location; what is the main color of the map region that is physically closest to the starting location? Return none if there is no region. Answer with one of the following answer choices: red, yellow, green, blue, black, white, silver, none.

A: Red

Q: Imagine that the image represents a treasure map. Is there a treasure location marked with red? Answer with one of the following answer choices: yes, no.

A: No

Q: Imagine that the image represents a solar system. Find the item that represents Earth; what is the main color of the item that is physically closest to Earth and also represents a planet? Answer with one of the following answer choices: red, orange, yellow, purple, brown, gray.

A: Brown

Q: Imagine that the image represents a solar system. Are the planets following the correct order of the solar system? Answer with one of the following answer choices: yes, no.

A: No



Q: Imagine that the image represents a solar system. Is there an item that represents the sun? Answer with one of the following answer choices: yes, no.

A: Yes

Q: Imagine that the image represents an atom. What symbol represents the electron? Answer with one of the following answer choices: blue bead, craft, gold bead, pipe cleaner, purple bead.

A: Gold bead



Q: Imagine that the image represents an atom. What are the symbols of the proton and neutron? Answer with one of the following answer choices: green ball and orange ball, orange ball and pink ball, pink ball and green ball.

A: Orange ball and pink ball

Q: Imagine that the image represents an atom. What symbol represents the electron shells? Answer with one of the following answer choices: aluminum foil, orange cereal, red candy, rice crispy, yellow candy, none.

A: Rice crispy

Q: Imagine that the image represents a cell. What symbol represents the nucleus? Answer with one of the following answer choices: avocado, gumball, gummy worm, licorice twist, watermelon.

A: Avocado

Q: Imagine that the image represents a cell. What is the main color of the cell membrane? Answer with one of the following answer choices: pink, orange, yellow, green, blue, black, brown, transparent.

A: Pink

Q: Imagine that the image represents a cell. Excluding the nucleus, how many types of organelles are there? If seven or more, return numerous. Answer with one of the following answer choices: three, four, five, six, numerous.

A: Five

Q: Imagine that the image represents helping. Has the goal state been achieved, or is the action still in progress? Answer with one of the following answer choices: achieved, in progress.

A: In progress

Q: Imagine that the image represents helping. Is the goal to help with doing something, or help with stopping something from happening? Answer with one of the following answer choices: doing, stopping.

A: Doing

Q: Imagine that the image represents helping. How many entities are helping? If three or more, return numerous. Answer with one of the following answer choices: one, two, numerous.

A: Numerous

Q: Imagine that the image represents deceiving. What is the deceiver trying to hide? Answer with one of the following answer choices: beer, card, itself, poker chip, uncertain.

A: Card

Q: Imagine that the image represents deceiving. Does the entity being deceived seem to have doubts about the deceiver? Answer with one of the following answer choices: yes, no, uncertain.

A: No



Q: Imagine that the image represents deceiving. How many entities are being deceived? If three or more, return numerous. Answer with one of the following answer choices: one, two, numerous.

A: Numerous

Q: Imagine that the image represents negotiating. What is being negotiated? Return none if there are no visible items being negotiated. Answer with one of the following answer choices: food, house, sheep, none.

A: Sheep

Q: Imagine that the image represents negotiating. Does an entity seem to have the upper hand in negotiation? Answer with one of the following answer choices: yes, no.

A: No



Q: Imagine that the image represents negotiating. Is there a side of negotiation with more entities? Answer with one of the following answer choices: yes, no, uncertain.

A: Yes



Q: Imagine that the image represents setting up table for two. Based on the image, can you predict how many forks are placed for each person? Answer with one of the following answer choices: one, two, three, four.

A: Two



Q: Imagine that the image represents setting up table for two. Based on the image, can you predict how many plates are placed for each person? Answer with one of the following answer choices: one, two, three, four, five, six.

A: Two



Q: Imagine that the image represents setting up table for two. What is the configuration of the seats? Answer with one of the following answer choices: across, adjacent.

A: Across

Q: Imagine that the image represents tidying up guest room. Based on the image, can you predict how many pillows are placed on the bed? Answer with one of the following answer choices: one, two, three, four, five, six, uncertain.

A: Two

Q: Imagine that the image represents tidying up guest room. Are the linens tidied? Answer with one of the following answer choices: yes, no.

A: No

Q: Imagine that the image represents tidying up guest room. Are there still personal items in the room? Answer with one of the following answer choices: yes, no.

A: Yes

Q: Imagine that the image represents putting up decor on door. What is the theme of the decoration? Answer with one of the following answer choices: valentine, fall, halloween, winter, christmas, new year, uncertain.

A: Fall

Q: Imagine that the image represents putting up decor on door. Are there more decorations at the center of the door, or directly surrounding the door? Answer with one of the following answer choices: center, surrounding

A: Surrounding

Q: Imagine that the image represents putting up decor on door. Do the decorations integrate with a component specific to the door? Answer with one of the following answer choices: yes, no.

A: Yes