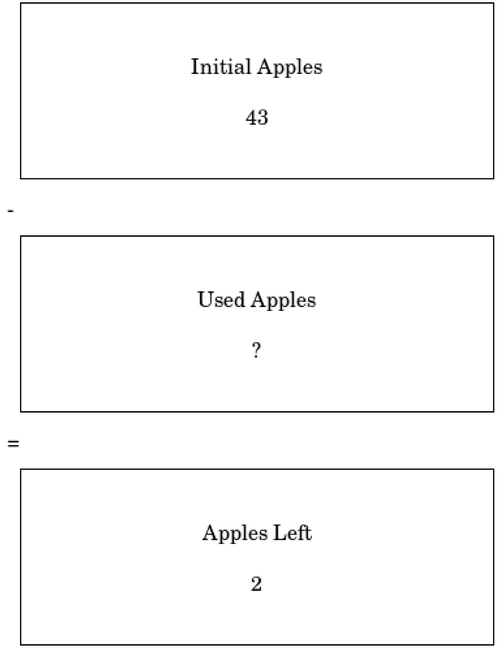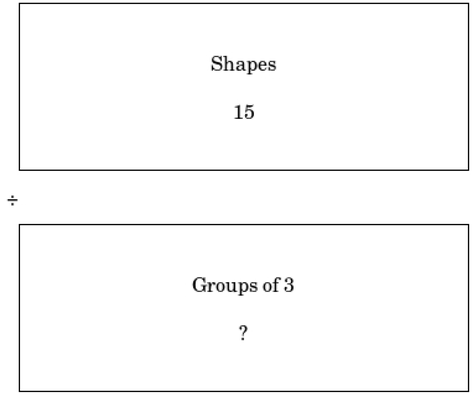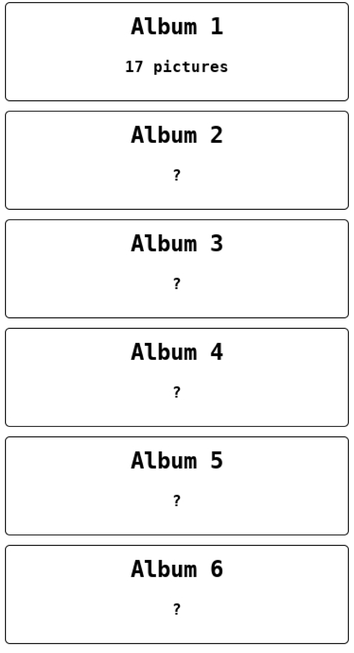	GSM-8K	SVAMP	ASDIV	MAWPS
Question:	The caretaker of the docks needs to buy some new line. He wants 3 feet of line for every foot of dock. Right now, there is 200 feet of dock, and he has 6 feet of new line. How many feet of line does he need to buy in total?	After making some pies, chef had 2 apples left. Initially he had 43 apples. How many apples did he use?	Dan has $ 3. For a total of $ 4 he bought 2 candy bar each one costing the same amount of money. How much did each candy bar cost?	Haley uploaded 65 pictures to Facebook. She put 17 pics into one album and put the rest into 6 different albums. How many pictures were in each album?
Image: