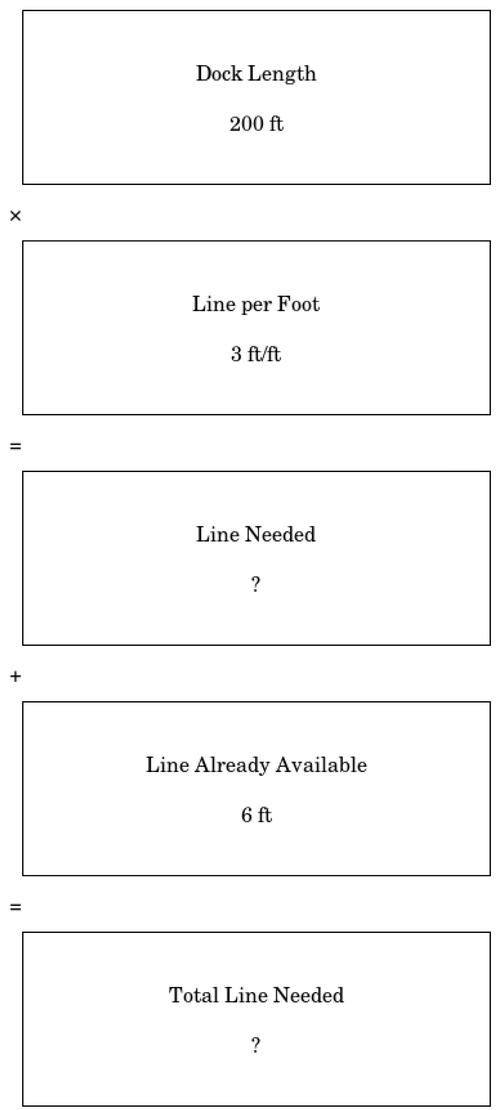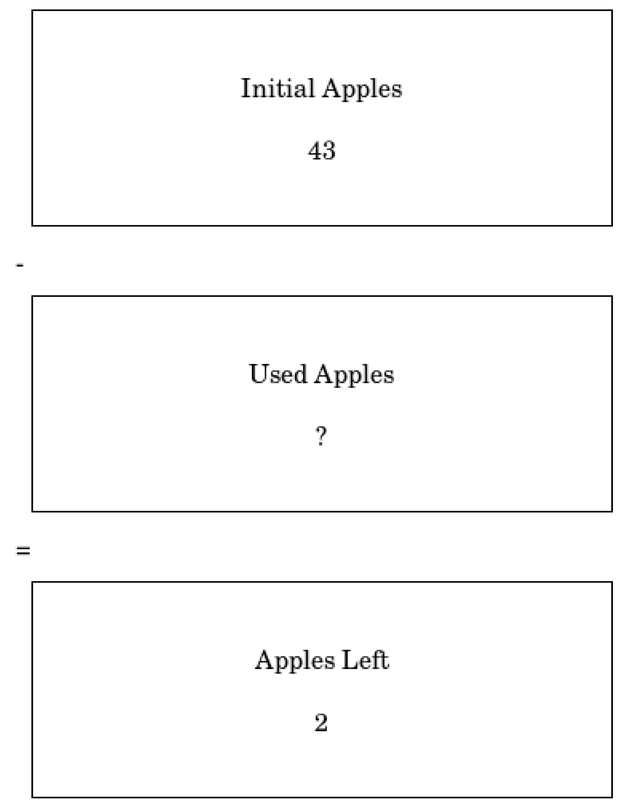	GSM8K	SVAMP	ASDIV
Question:	The caretaker of the docks needs to buy some new line. He wants 3 feet of line for every foot of dock. Right now, there is 200 feet of dock, and he has 6 feet of new line. How many feet of line does he need to buy in total?	After making some pies, chef had 2 apples left. Initially he had 43 apples. How many apples did he use?	Dan has $ 3. For a total of $ 4 he bought 2 candy bar each one costing the same amount of money. How much did each candy bar cost?
Image: